NAME _____ DATE _____ PERIOD _____

5-3 Practice

Inequalities in One Triangle

Use the figure at the right to determine which angle has the greatest measure.

1. $\angle 1, \angle 3, \angle 4$

2. $\angle 4, \angle 8, \angle 9$

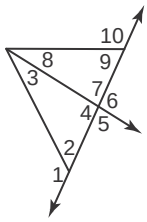

3. $\angle 2, \angle 3, \angle 7$

4. $\angle 7, \angle 8, \angle 10$

Use the Exterior Angle Inequality Theorem to list all angles that satisfy the stated condition.

5. measures are less than $m\angle 1$

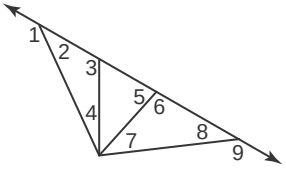

6. measures are less than $m\angle 3$

7. measures are greater than $m\angle 7$

8. measures are greater than $m\angle 2$

Use the figure at the right to determine the relationship between the measures of the given angles.

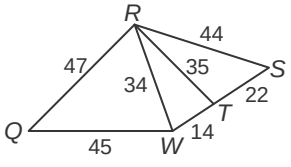

9. $m\angle QRW, m\angle RWQ$

10. $m\angle RTW, m\angle TWR$

11. $m\angle RST, m\angle TRS$

12. $m\angle WQR, m\angle QRW$

Use the figure at the right to determine the relationship between the lengths of the given sides.

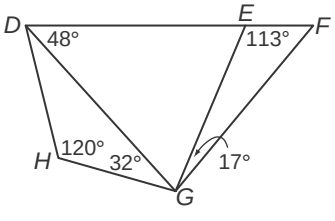

13. $\overline{DH}, \overline{GH}$

14. $\overline{DE}, \overline{DG}$

15. $\overline{EG}, \overline{FG}$

16. $\overline{DE}, \overline{EG}$
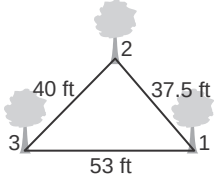
17. SPORTS The figure shows the position of three trees on one part of a disc golf course. At which tree position is the angle between the trees the greatest?